Friday 6th February 2026

Year 1 Arithmetic Homework

Spring 1 week 5

Please use the questions as a guide. The children do not need to have the questions printed out and can complete them directly in their homework books.

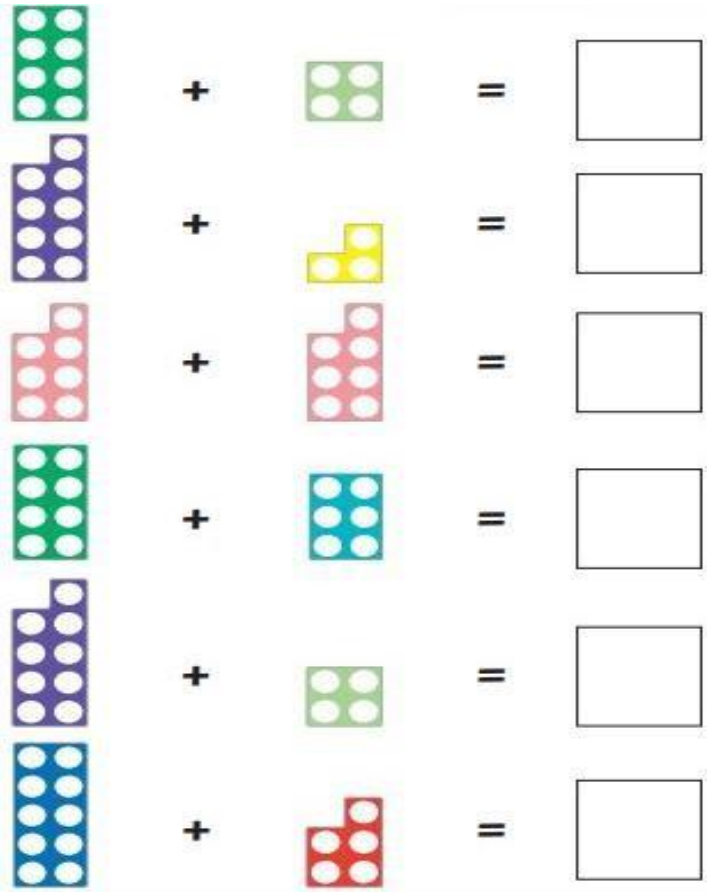

First, there are 9 children on the bus.

Then, 5 more children get on the bus.

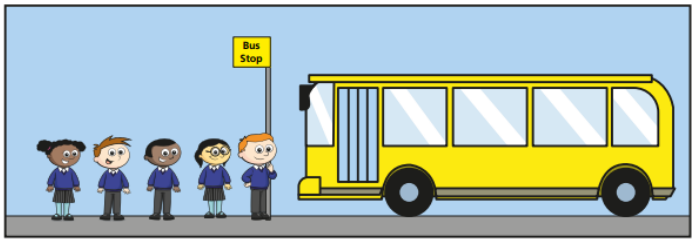

How many children are on the bus now?

Complete the ten frames and the sentences.

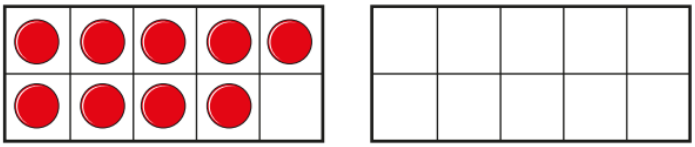

☐ + ☐ = ☐

Now, there are ☐ children on the bus.

Complete the sentences.

11 has ☐ ten and ☐ one.

12 has ☐ ten and ☐ ones.

13 has ☐ ten and ☐ ones.

Match the numbers to the pictures.

eleven	12	13	fourteen